CAMBRIDGE
International Education

Cambridge IGCSE™

CANDIDATE NAME

CENTRE NUMBER

CANDIDATE NUMBER

246242192 4

CAMBRIDGE INTERNATIONAL MATHEMATICS **0607/21**

Paper 2 Non-calculator (Extended) **May/June 2026**

1 hour 30 minutes

You must answer on the question paper.

You will need: Geometrical instruments

INSTRUCTIONS

- Answer **all** questions.
- Use a black or dark blue pen. You may use an HB pencil for any diagrams or graphs.
- Write your name, centre number and candidate number in the boxes at the top of the page.
- Write your answer to each question in the space provided.
- Do **not** use an erasable pen. Do **not** use correction fluid or tape.
- Do **not** write on any bar codes.
- Calculators must **not** be used in this paper.
- You may use tracing paper.
- You must show all necessary working clearly. You will be given marks for correct methods even if your answer is incorrect.

INFORMATION

- The total mark for this paper is 75.
- The number of marks for each question or part question is shown in brackets [ ].

This document has **12** pages.

© Cambridge University Press & Assessment 2026

List of formulas

Area, A, of triangle, base b, height h.	$A = \frac{1}{2}bh$
Area, A, of circle of radius r.	$A = \pi r^2$
Circumference, C, of circle of radius r.	$C = 2\pi r$
Curved surface area, A, of cylinder of radius r, height h.	$A = 2\pi rh$
Curved surface area, A, of cone of radius r, sloping edge l.	$A = \pi rl$
Surface area, A, of sphere of radius r.	$A = 4\pi r^2$
Volume, V, of prism, cross-sectional area A, length l.	$V = Al$
Volume, V, of pyramid, base area A, height h.	$V = \frac{1}{3}Ah$
Volume, V, of cylinder of radius r, height h.	$V = \pi r^2 h$
Volume, V, of cone of radius r, height h.	$V = \frac{1}{3}\pi r^2 h$
Volume, V, of sphere of radius r.	$V = \frac{4}{3}\pi r^3$
For the equation $ax^2 + bx + c = 0$, where $a \neq 0$,	$x = \frac{-b \pm \sqrt{b^2 - 4ac}}{2a}$

For the triangle shown,

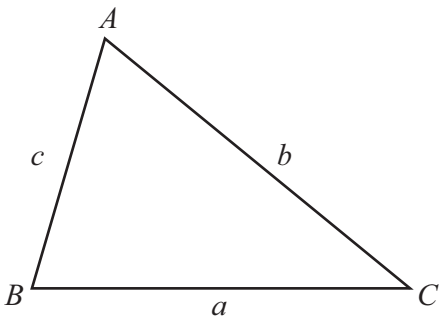

$$\frac{a}{\sin A} = \frac{b}{\sin B} = \frac{c}{\sin C}$$

$$a^2 = b^2 + c^2 - 2bc\cos A$$

$$\text{Area} = \frac{1}{2}ab\sin C$$

© Cambridge University Press & Assessment 2026

DO NOT WRITE IN THIS MARGIN
DO NOT WRITE IN THIS MARGIN
DO NOT WRITE IN THIS MARGIN
DO NOT WRITE IN THIS MARGIN
DO NOT WRITE IN THIS MARGIN

Calculators must **not** be used in this paper.

1 Write $\frac{31}{7}$ as a mixed number.

..... [1]

2 Write 30% as a fraction.

..... [1]

3 Write down the value of $\sqrt{196}$.

..... [1]

4 $H = 2W - 3X$

Find the value of W when $H = 4$ and $X = 2$.

$W =$ ..... [2]

5 $\mathbf{a} = \begin{pmatrix} 6 \\ -4 \end{pmatrix}$ $\mathbf{b} = \begin{pmatrix} 1 \\ 2 \end{pmatrix}$

Find $\frac{1}{2}\mathbf{a} + \mathbf{b}$.

$\begin{pmatrix} \quad \\ \quad \end{pmatrix}$ [2]

DO NOT WRITE IN THIS MARGIN

© Cambridge University Press & Assessment 2026

6 Work out the size of an interior angle of a regular decagon.

..... [2]

7 **(a)** A fair coin has sides heads (H) and tails (T).
A fair 4-sided spinner is numbered 1, 2, 3 and 4.
The coin and the spinner are both spun.

(i) Complete the sample space diagram to show all the outcomes.

	1	**2**	**3**	**4**
H	H1			
T				

[1]

(ii) Find the probability that the outcome is a head and an odd number.

..... [2]

(b) Another spinner can land on black or white.
The probability that it lands on black is $\frac{1}{5}$.
The spinner is spun 3 times.

Find the probability that it lands on white 3 times.

..... [2]

DO NOT WRITE IN THIS MARGIN

(c) A bag contains 4 blue balls and 3 red balls.
Rita takes 2 balls from the bag at random without replacement.

Work out the probability that the 2 balls are the same colour.

..... [3]

8 The equation of a line is $4y - x = 12$.

Find the gradient and the y-intercept of the line.

gradient = ...

y-intercept = ...
[3]

9 Expand and simplify.

$$(2 - x)(4 + x)$$

..... [2]

DO NOT WRITE IN THIS MARGIN

10 **(a)** Solve.

$$5(2n-3) = 40$$

$n =$ ..... [3]

(b) Solve the simultaneous equations.

$$5x - y = 18$$
$$x + 2y = 8$$

$x =$ .....

$y =$ .....

[3]

(c) Solve the inequality.

$$17 + 2n < 5n - 10$$

..... [2]

DO NOT WRITE IN THIS MARGIN DO NOT WRITE IN THIS MARGIN DO NOT WRITE IN THIS MARGIN DO NOT WRITE IN THIS MARGIN DO NOT WRITE IN THIS MARGIN

© Cambridge University Press & Assessment 2026

11 The diagram shows a shape that is a quarter of a circle.

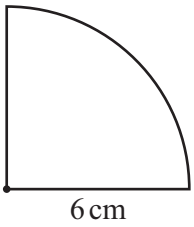

NOT TO SCALE

The radius of the circle is 6 cm.

Find the perimeter of the shape.
Give your answer in terms of π.

..... cm [2]

12 Describe fully the **single** transformation that maps the graph of $y = g(x)$ onto the graph of $y = g(x-2)$.

.....

..... [2]

DO NOT WRITE IN THIS MARGIN

13 **(a)** A, B, C and D are points on a circle.

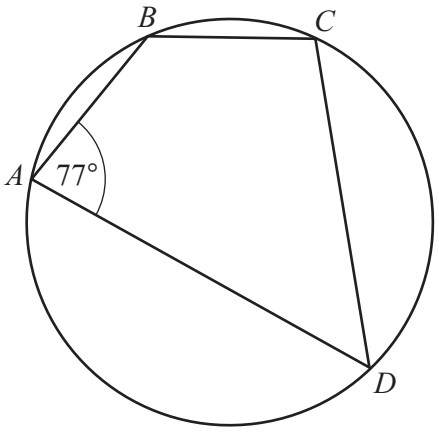

NOT TO SCALE

Complete the sentence giving a geometrical reason for your answer.

Angle BCD = ... because .....

..... [2]

(b) P, Q, R and S are points on the circle centre O.

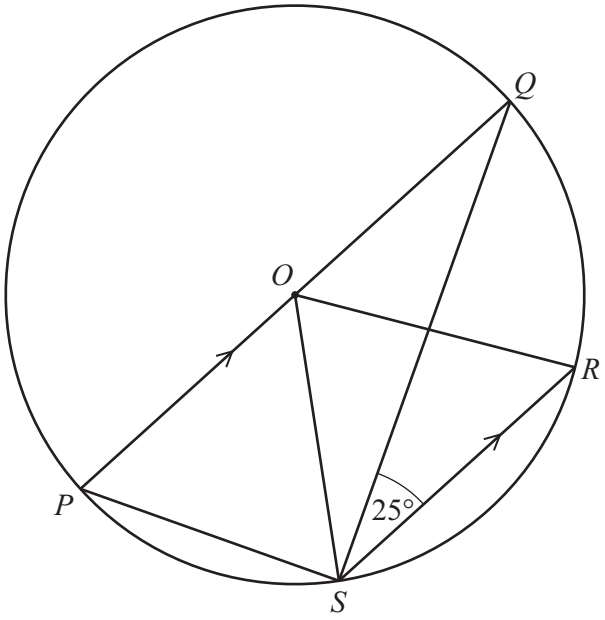

NOT TO SCALE

Angle $QSR = 25°$.
POQ is parallel to SR.

Find angle SOR.

angle SOR = ... [3]

© Cambridge University Press & Assessment 2026

DO NOT WRITE IN THIS MARGIN
DO NOT WRITE IN THIS MARGIN
DO NOT WRITE IN THIS MARGIN
DO NOT WRITE IN THIS MARGIN
DO NOT WRITE IN THIS MARGIN

14 Find the value of $27^{-\frac{2}{3}}$.

..... [2]

15 **(a)** Write 20 400 in standard form.

..... [1]

(b) Work out $4.2 \times 10^{16} + 3.1 \times 10^{15}$.
Give your answer in standard form.

..... [2]

16 Simplify.

$$\sqrt{75} + \sqrt{48} - \sqrt{12}$$

..... [3]

17 Find the highest common factor (HCF) of $16x^3y^4$ and $24x^2y^5$.

..... [2]

DO NOT WRITE IN THIS MARGIN

18 Write down the value of $\log_4 64$.

..... [1]

19 $3^{12} \div 3^n = 3^{2n}$

Find the value of n.

$n =$ ..... [2]

20 A is the point (–4, 3) and B is the point (8, –1).

(a) Find the length of AB.
Give your answer as a surd.

..... [3]

(b) Find the equation of the perpendicular bisector of AB.
Give your answer in the form $y = mx + c$.

$y =$ ..... [5]

DO NOT WRITE IN THIS MARGIN

© Cambridge University Press & Assessment 2026

DO NOT WRITE IN THIS MARGIN
DO NOT WRITE IN THIS MARGIN
DO NOT WRITE IN THIS MARGIN
DO NOT WRITE IN THIS MARGIN
DO NOT WRITE IN THIS MARGIN

21 **(a)** Write as a single fraction in its simplest form.

$$\frac{2}{x-3} - \frac{5x}{x+1}$$

..... [3]

(b) Simplify.

$$\frac{4x^2-9}{2x^2+5x-12}$$

..... [4]

22 $f(w) = \frac{1}{\cos w} + 2$ for values of w between 0° and 360°, $w \neq 90°$ and $w \neq 270°$.

Solve $f(w) = 0$.

..... [3]

Question 23 is on the back page.

23 In this question, all lengths are in centimetres.
The diagram shows a cone and a sphere.

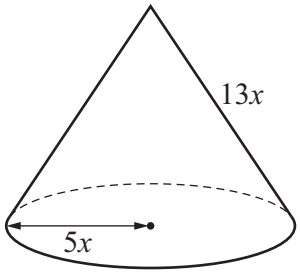

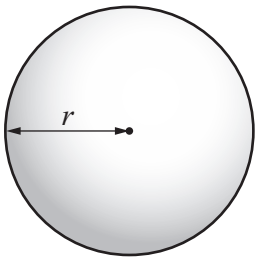

NOT TO SCALE

The radius of the cone is $5x$.
The sloping edge of the cone is $13x$.
The radius of the sphere is r.
The volume of the cone is equal to the volume of the sphere.

Show that $r^3 = 75x^3$.

[5]

Permission to reproduce items where third-party owned material protected by copyright is included has been sought and cleared where possible. Every reasonable effort has been made by the publisher (Cambridge University Press & Assessment) to trace copyright holders, but if any items requiring clearance have unwittingly been included, the publisher will be pleased to make amends at the earliest possible opportunity.

To avoid the issue of disclosure of answer-related information to candidates, all copyright acknowledgements are reproduced online in our Copyright Acknowledgements Booklet. This is produced for each series of examinations and is freely available to download at www.cambridgeinternational.org after the live examination series.

Cambridge International Education is the name of our awarding body and a part of Cambridge University Press & Assessment, which is a department of the University of Cambridge.

© Cambridge University Press & Assessment 2026

DO NOT WRITE IN THIS MARGIN
DO NOT WRITE IN THIS MARGIN
DO NOT WRITE IN THIS MARGIN
DO NOT WRITE IN THIS MARGIN
DO NOT WRITE IN THIS MARGIN